The Official Cambridge Guide to IELTS

Writing

학습목표

- Select and report on the main features and make comparisons where relevant.
- Display a wide range of vocabulary.
- Make sure not to simply repeat your own words or the words from the question.

PRACTICE TEST 2
WRITING

P.188

TASK 1

P.188

The graph and table below show the average monthly temperatures and the average number of hours of sunshine per year in three major cities.

Summarise the information by selecting and reporting the main features and make comparisons where relevant.

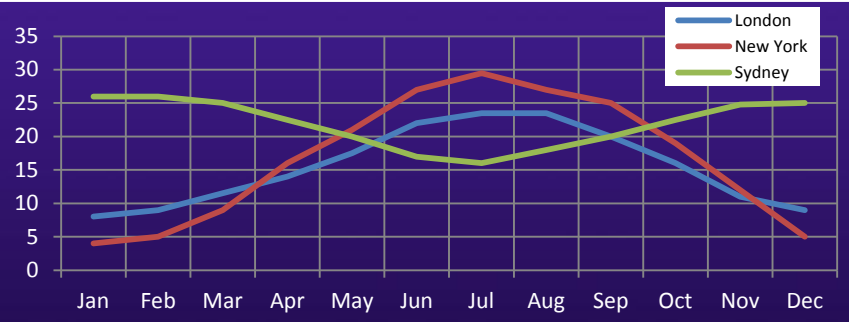

Total annual hours of sunshine for London, New York and Sydney

London	1,180
New York	2,535
Sydney	2,473

Structure

P.188

Introduction	The data provides information on
Overall	Particular patterns
Body 1	From the graph, In contrast, On the other hand,
Body 2	As far as it is concerned, Clearly,

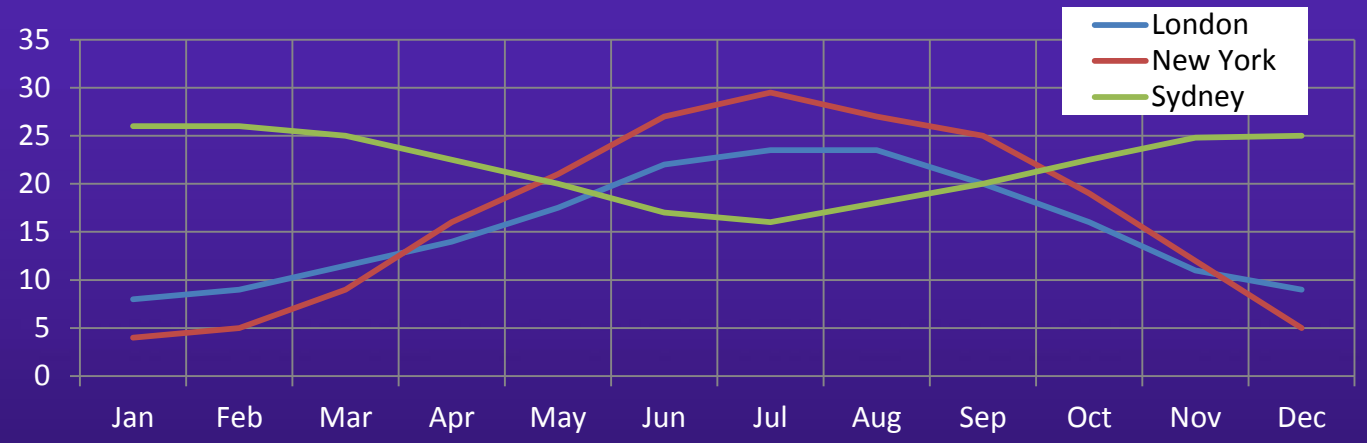

Total annual hours of sunshine for London, New York and Sydney

London	1,180
New York	2,535
Sydney	2,473

Introduction

P.188

The graph and table below show the average monthly temperatures and the average number of hours of sunshine per year in three major cities.

Introduction

P.188

The graph and table below show the average monthly temperatures and the average number of hours of sunshine per year in three major cities.

The average monthly temperatures
Annual hours of sunshine per year
3 cities

Introduction

P.188

The graph and table below show the average monthly temperatures and the average number of hours of sunshine per year in three major cities.

The average monthly temperatures
Annual hours of sunshine per year
3 cities

The data provides information on _____ per month and _____ of sunshine in _____ , _____ and _____.

Introduction

P.188

The graph and table below show the average monthly temperatures and the average number of hours of sunshine per year in three major cities.

The average monthly temperatures
Annual hours of sunshine per year
3 cities

The data provides information on average temperatures per month and annual hours of sunshine in London, New York and Sydney.

Introduction

P.188

The graph and table below show the average monthly temperatures and the average number of hours of sunshine per year in three major cities.

Introduction

P.188

The graph and table below show the average monthly temperatures and the average number of hours of sunshine per year in three major cities.

Particular patterns
Month

As an overall trend, there are _____ of temperatures depending on each _____ in the places given.

Introduction

P.188

The graph and table below show the average monthly temperatures and the average number of hours of sunshine per year in three major cities.

Particular patterns
Month

As an overall trend, there are particular patterns of temperatures depending on each month in the places given.

Body - Analysis

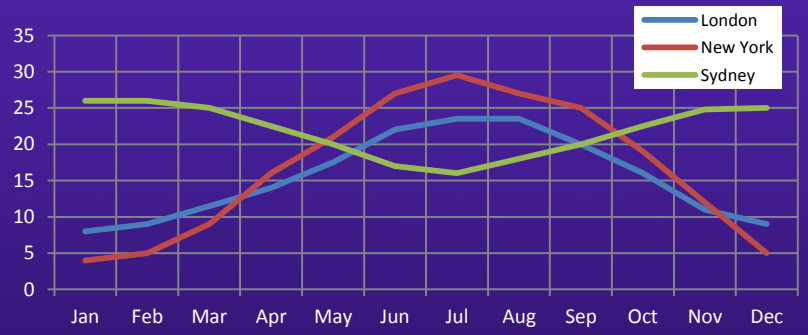

Body - Analysis

P.188

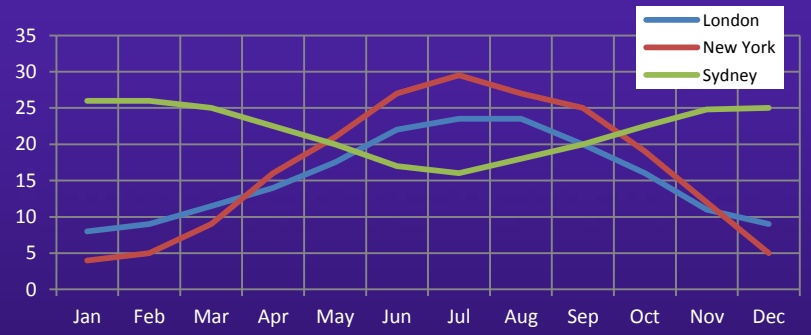

London and New York

NY = warmer and colder

July/August (Peak)

23°(London)/29°(NY)

Body - Analysis

P.188

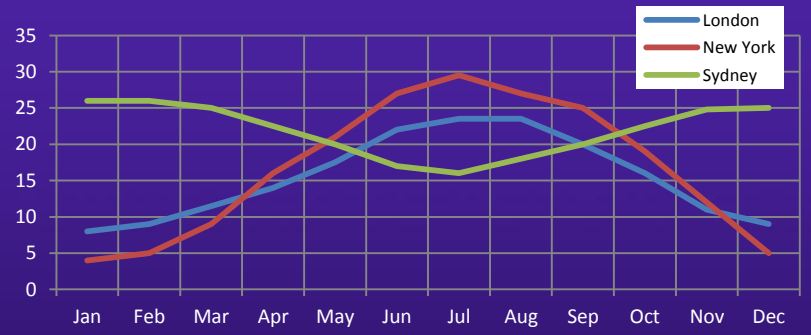

London and New York

NY = warmer and colder

July/August (Peak)

23°(London)/29°(NY)

From the graph, the temperature patterns for _____ and _____ are similar, although New York has _____ summers and _____ winters. In both cities, _____ occur in July/August, at _____ ° in London and _____° in New York.

Body - Analysis

P.188

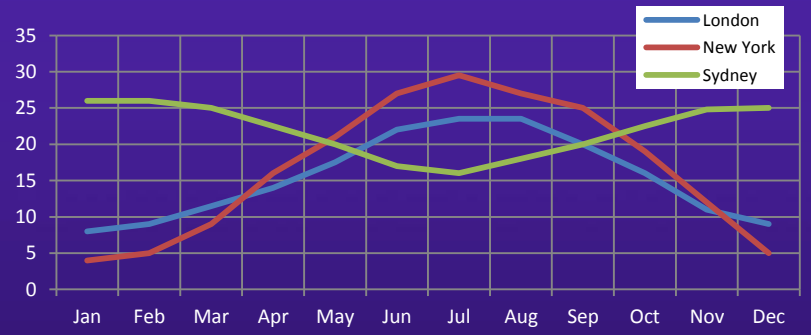

London and New York

NY = warmer and colder

July/August (Peak)

23°(London)/29°(NY)

From the graph, the temperature patterns for London and New York are similar, although New York has warmer summers and colder winters. In both cities, peaks occur in July/August, at 23° in London and 29° in New York.

Body - Analysis

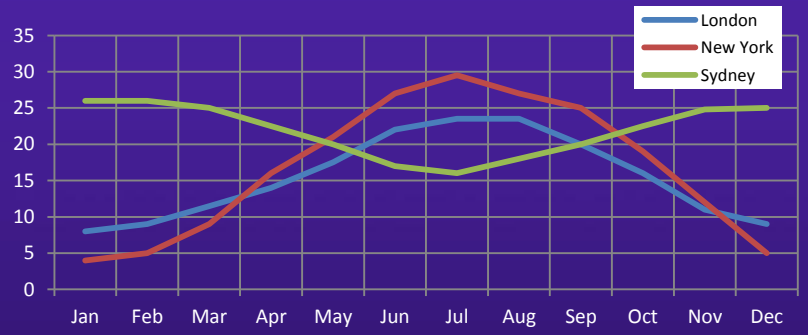

Body - Analysis

P.188

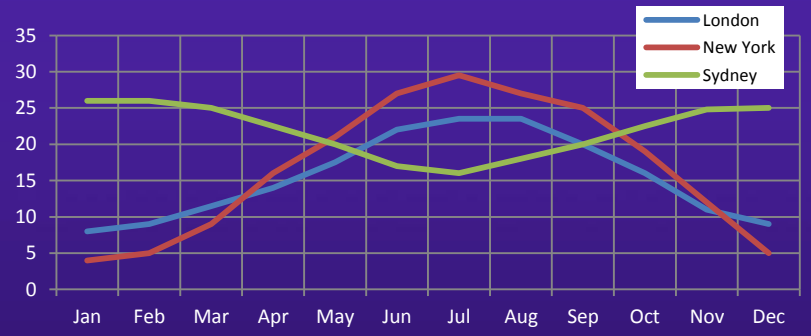

Sydney

Dec/Jan = 25 (hot)

NY and London = 5/8

Body - Analysis

P.188

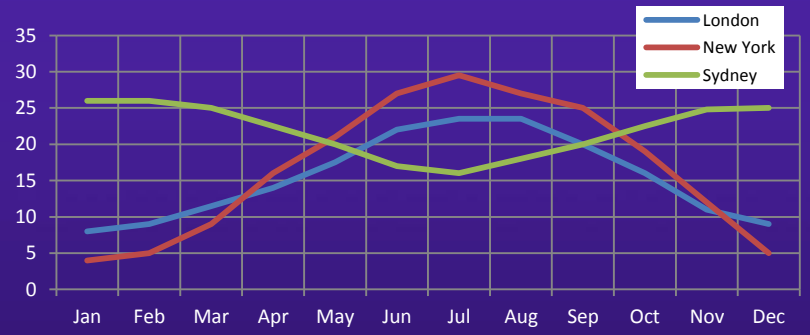

Sydney

Dec/Jan = 25 (hot)

NY and London = 5/8

In contrast, Sydney's _____ weather is in December/January when temperatures average ____°. During this period, New York's temperatures dip to an average of around ____°, compared with ____° in London.

Body - Analysis

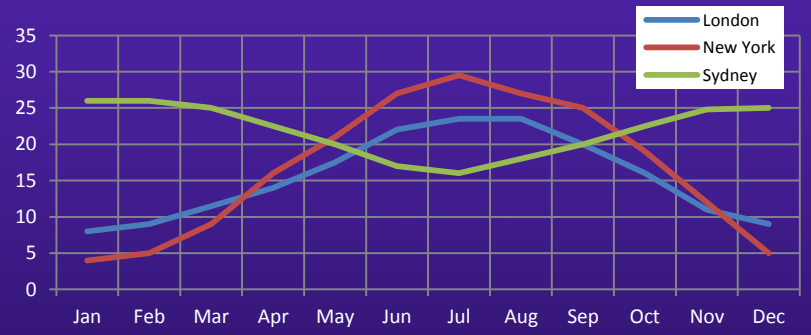

Sydney

Dec/Jan = 25 (hot)

NY and London = 5/8

In contrast, Sydney's hottest weather is in December/January when temperatures average 25°. During this period, New York's temperatures dip to an average of around 5°, compared with 8° in London.

Body - Analysis

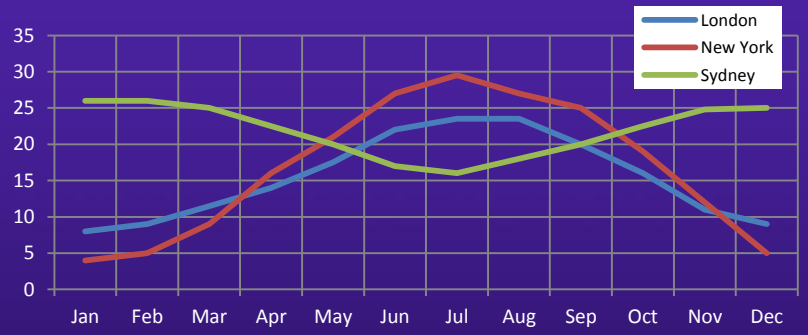

Body - Analysis

P.188

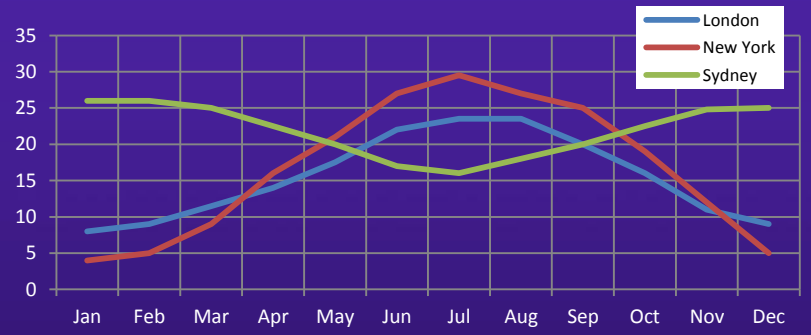

Sydney

July = 15

Body - Analysis

P.188

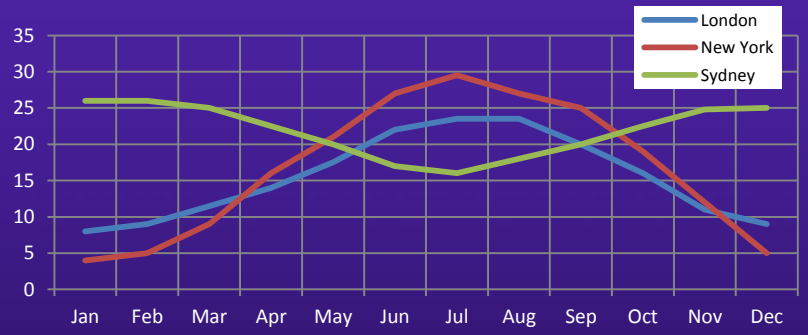

Sydney

July = 15

On the other hand, Sydney's _____ average temperatures in _____ are just over ____ °.

Body - Analysis

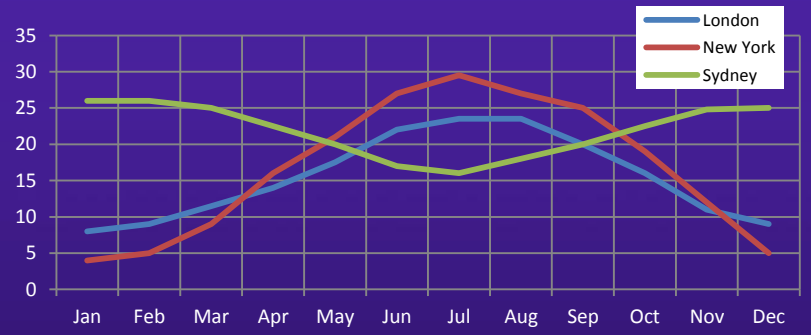

Sydney

July = 15

On the other hand, Sydney's lowest average temperatures in July are just over 15°.

Body - Analysis

P.188

Total annual hours of sunshine for London, New York and Sydney

London	1,180
New York	2,535
Sydney	2,473

Body - Analysis

P.188

Total annual hours of sunshine for London, New York and Sydney

London	1,180
New York	2,535
Sydney	2,473

NY/Sydney = similar

London = lower

Body - Analysis

P.188

Total annual hours of sunshine for London, New York and Sydney

London	1,180
New York	2,535
Sydney	2,473

NY/Sydney = similar

London = lower

As far as hours of sunshine are concerned, _____ and _____ have _____ averages of 2,535 and 2,473 hours respectively. _____ , however, has a much _____ average of 1,180 hours.

Body - Analysis

Total annual hours of sunshine for London, New York and Sydney

London	1,180
New York	2,535
Sydney	2,473

NY/Sydney = similar

London = lower

As far as hours of sunshine are concerned, New York and Sydney have similar averages of 2,535 and 2,473 hours respectively. London, however, has a much lower average of 1,180 hours.

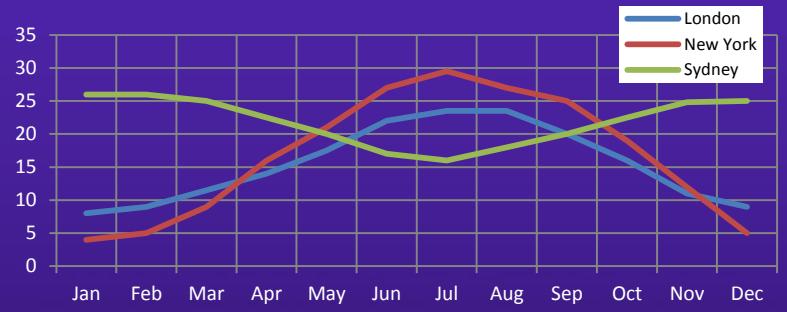

Total annual hours of sunshine for London, New York and Sydney

London	1,180
New York	2,535
Sydney	2,473

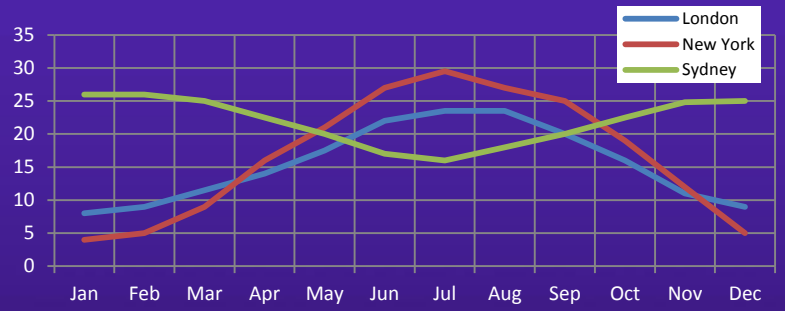

Total annual hours of sunshine for London, New York and Sydney

London	1,180
New York	2,535
Sydney	2,473

London = the coldest city/the fewest hours
NY = the hottest
Sydney = the warmest

P.188

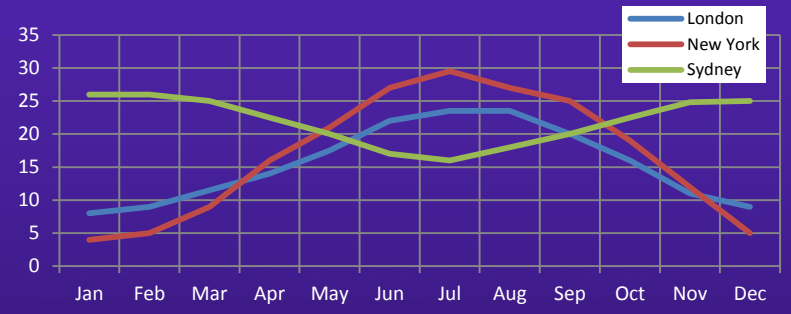

Total annual hours of sunshine for London, New York and Sydney

London	1,180
New York	2,535
Sydney	2,473

London = the coldest city/the fewest hours
NY = the hottest
Sydney = the warmest

Clearly, _____ is the _____ city and has the _____ hours of sunshine. _____ has the _____ summers, but _____ enjoys the _____ overall climate.

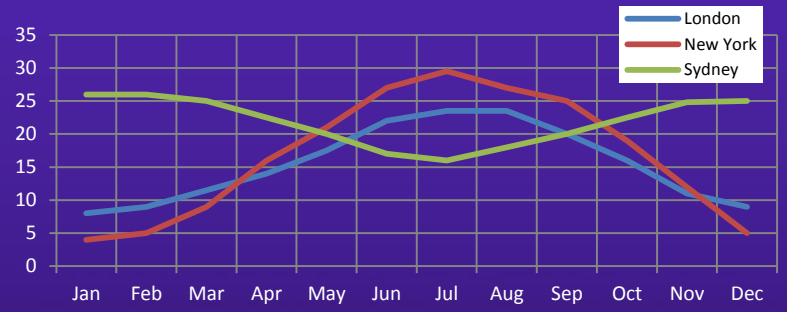

Total annual hours of sunshine for London, New York and Sydney

London	1,180
New York	2,535
Sydney	2,473

London = the coldest city/the fewest hours
NY = the hottest
Sydney = the warmest

Clearly, London is the coldest city and has the fewest hours of sunshine. New York has the hottest summers, but Sydney enjoys the warmest overall climate.

Writing Task 1, Sample Answer

The data provides information on average temperatures and annual hours of sunshine in London, New York and Sydney. As an overall trend, there are particular patterns of temperatures depending on each month in the places given.

From the graph, the temperature patterns for London and New York are similar although New York has warmer summers and colder winters. In both cities, peaks occur in July/August, at 23° in London and 29° in New York.

Writing Task 1, Sample Answer

In contrast, Sydney‘s hottest weather is in December/January when temperatures average 25°. During this period, New York's temperatures dip to an average of around 5°, compared with 8° in London. On the other hand, Sydney's lowest average temperatures in July are just over 15°.

Writing Task 1, Sample Answer

As far as hours of sunshine are concerned, New York and Sydney have similar averages of 2,535 and 2,473 hours respectively. London, however, has a much lower average of 1,180 hours.

Clearly, London is the coldest city and has the fewest hours of sunshine. New York has the hottest summers, but Sydney enjoys the warmest overall climate.

The Official Cambridge Guide to IELTS

Writing

The Official Cambridge Guide to IELTS

Writing